NAME: Period: _____

THE NUMBER SYSTEM

CCSS 7.NS.1d

Classwork Tuesday, August 25, 2015

Working with Integers

Using appropriate arrow notations on number lines such as the one pictured below, represent the expressions given and find the results. Use a new number line for each sentence.

1. $-8 + 12 = ?$

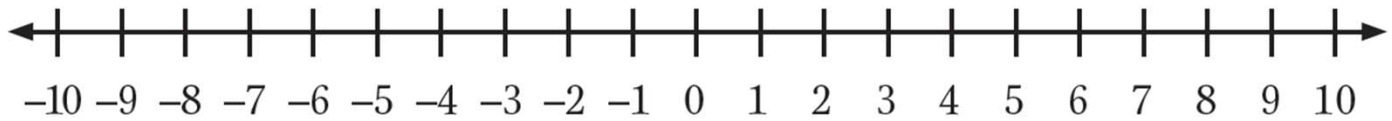

2. $(-7) + (-3) = ?$

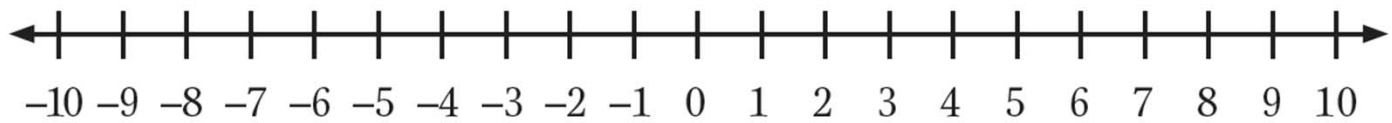

3. $5 + (-9) = ?$

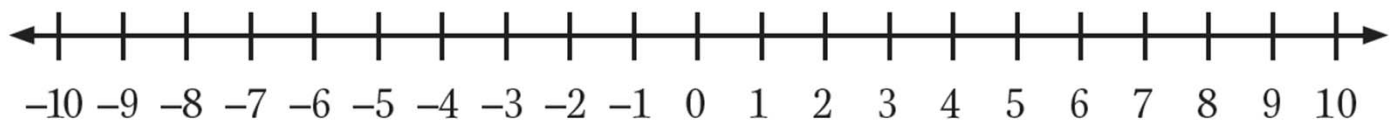

NAME: Period: _____

THE NUMBER SYSTEM

CCSS 7.NS.1d

Classwork Tuesday, August 25, 2015

Chip-Board Integers

Andrew and Brittany are exploring integers by drawing representations using black and white circular chips. The white chips represent positive numbers. The black chips represent negative numbers. Write a number sentence to symbolize each set of chip boards that they have drawn.

1. Chip board 1

Chip board 2



Chip board 3

2. Chip board 1



Chip board 2

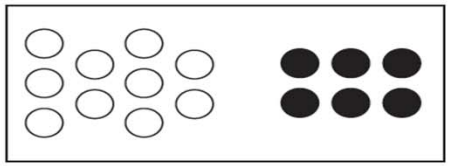

Chip board 3

3. Chip board 1



Chip board 2

Chip board 3